Number Walls: 3-Row (No Regrouping)

Grade 2 · Up to 100

Grade 2 · Numbers up to 100 · Starter ()

Name: _____ Date: _____

Add two neighboring bricks together and write their sum in the brick above.

Max's Tip
Two bricks side by side always add up to the brick directly above them!

a)

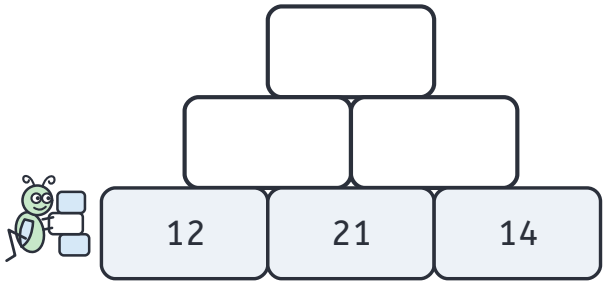

b)

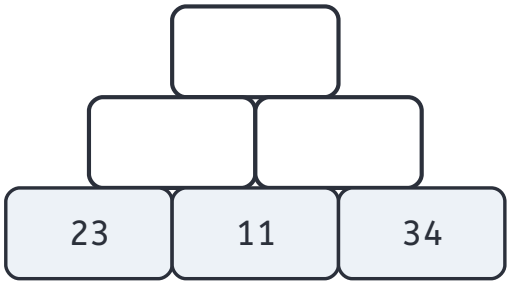

c)

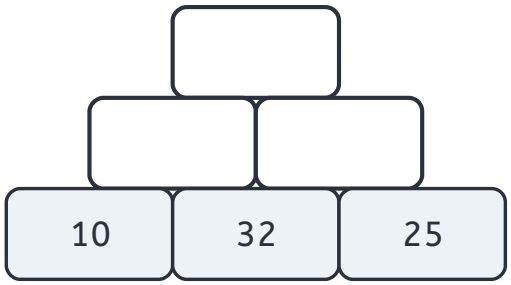

d)

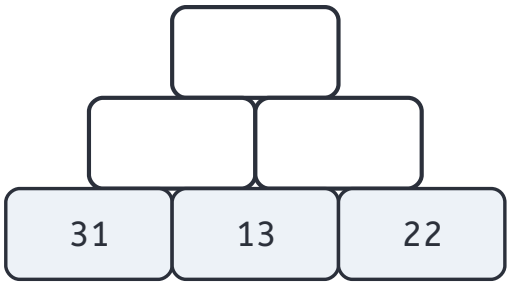

e)

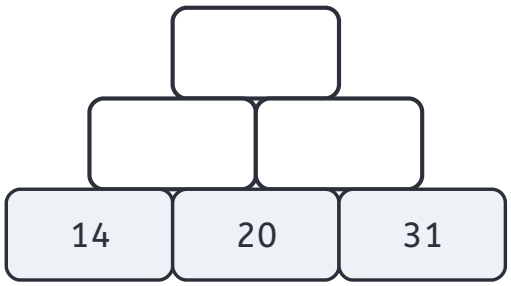

f)

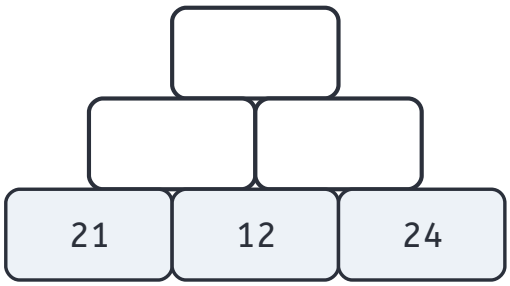

© Flip & Max · Free for home & classroom use (non-commercial)

Great job!

Number Walls: 3-Row (No Regrouping)

Grade 2 · Numbers up to 100 · Starter ()

Grade 2 · Up to 100

Answer Key

Name: _____ Date: _____

Add two neighboring bricks together and write their sum in the brick above.

Max's Tip
Two bricks side by side always add up to the brick directly above them!

a)

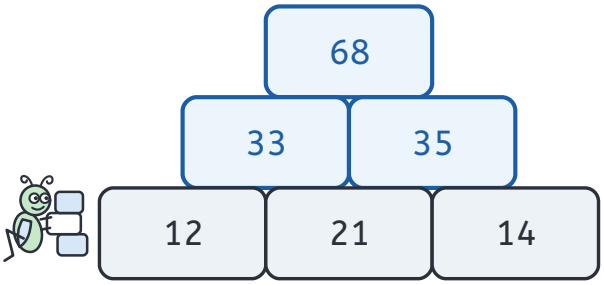

b)

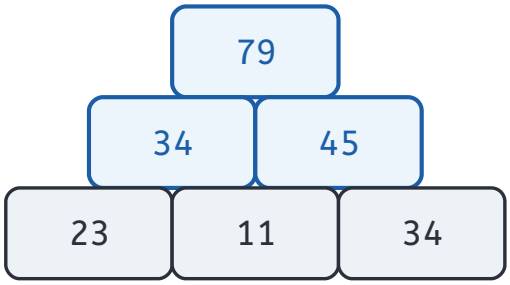

c)

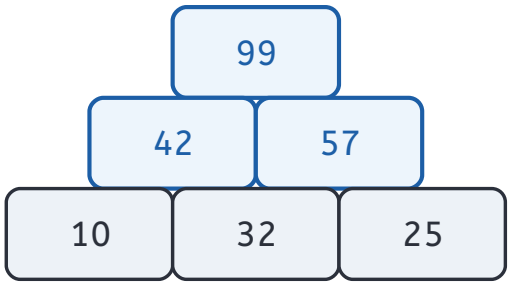

d)

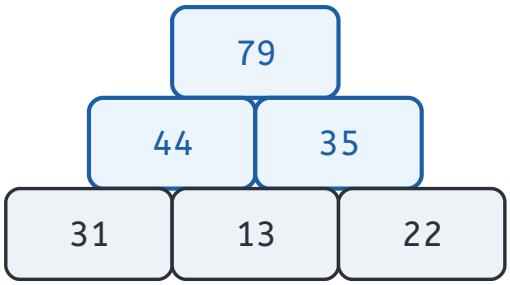

e)

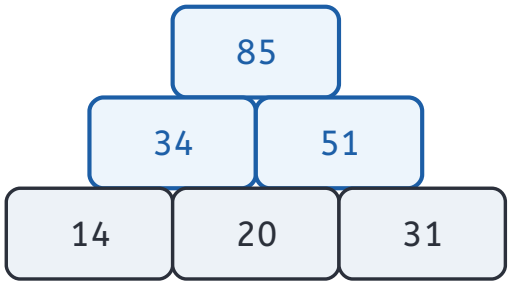

f)

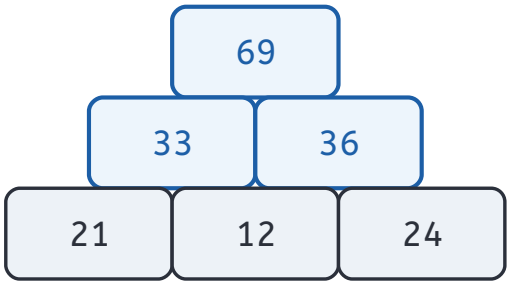

© Flip & Max · Free for home & classroom use (non-commercial)

Great job!